NAMA: ..... KELAS: ..... TARIKH: .....



UNIT 10 PANJANG

A Tulis ukuran panjang yang ditandakan. 10.2(ii) B3D5E3(a)

1 

= ☐

2 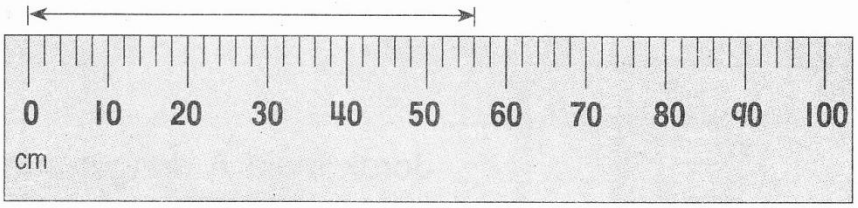

= ☐

3 

= ☐

4 

= ☐

5 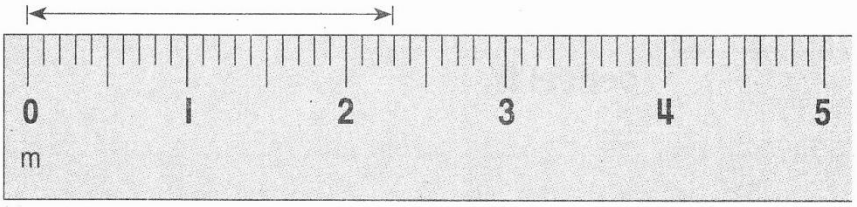

= ☐

Tema	Band	Standard Kandungan	Standard Pembelajaran	Deskriptor	Evidens	Standard Prestasi
Panjang	3	10.2 Mengukur dalam unit sentimeter dan meter.	10.2(ii)	B3D5	E3	B3D5E3(a)

PENILAIAN ☐ Menguasai ☐ Tidak Menguasai Tandatangan guru: _____